All rights reserved. No part of this publication may be reproduced, distributed, or transmitted in any form or by any means, electronic, mechanical, photocopying, recording or otherwise, or stored in any retrieval system of any nature without the permission of cracku.in, application for which shall be made to support@cracku.in

Downloaded from cracku.in

SSC CHSL 5th August 2021 Shift-1

English Language

1. **Select the most appropriate word to fill in the blank.**
   Today you may not _____ what you hear, but that is the truth and you have to accept it.

A answer

B reply

C enjoy

D like

Answer: D

2. **Select the option that can be used as a one-word substitute for the given group of words.**
   The branch of physics concerned with the properties of sound

A Optics

B Photonics

C Mechanics

D Acoustics

Answer: D

3. **Select the most appropriate word to fill in the blank.**
   His voice was _____ by the sound of the helicopter.

A driven

B drawn

C dawned

D drowned

Answer: D

4. **Select the INCORRECTLY spelt word.**

A Resolute

B Hautily

C Discussion

D Evidence

Answer: B

SSC CHSL Free Mock Test

Downloaded from cracku.in

5. **Sentences of a paragraph are given below in jumbled order. Arrange the sentences in the right order to form a meaningful and coherent paragraph.**
A. As a result, he had a debt of 500 million US dollars at the time of his death.
B. Unfortunately, he began spending lavishly on anything he desired, not what he actually needed.
C. Michael Jackson, called the 'King of Pop Music', stayed at the top of his career for many years.
D. He was respected for his work culture; he would spend long nights at the studio to fix a note correctly in a song.

A DBAC

B CDBA

C BADC

D ADCB

Answer: B

6. **Select the most appropriate meaning of the given idiom.**
To have eggs on one's face

A To be embarrassed because of one's action

B To apply egg yolk on one's face for making it look beautiful

C To throw eggs on a speaker's face

D To buy eggs and break them

Answer: A

7. **Select the option that expresses the given sentence in passive voice.**
Sai Kumari gave Akhila a bouquet of lilies on her birthday.

A Akhila was given a bouquet of lilies on her birthday by Sai Kumari.

B Akhila was gave a bouquet of lilies on her birthday by Sai Kumari.

C Akhila is given a bouquet of lilies on her birthday by Sai Kumari.

D Akhila gave a bouquet of lilies on her birthday to Sai Kumari.

Answer: A

SSC CHSL Prevoius Papers (DOWNLOAD PDF)

8. **The following sentence has been divided into parts. One of them may contain an error. Select the part that contains the error from the given options. If you don't find any error, mark 'No error' as your answer.**
A probe has been ordered / by the incident / that occurred at the celebrations.

A A probe has been ordered

B that occurred at the celebrations

C by the incident

D No error

Answer: C

Downloaded from cracku.in

9. **Select the most appropriate ANTONYM of the given word.**
Disheveled

A Untidy

B Cluttered

C Ordered

D Unkempt

Answer: C

10. **Select the most appropriate synonym of the given word.**
Despicable

A Commendable

B Laudable

C Contemptible

D Desirable

Answer: C

SSC CGL Previous Papers (DOWNLOAD PDF)

11. **Select the most appropriate option to substitute the underlined segment in the given sentence. If there is no need to substitute it, select 'No substitution required'.**
India has identified a nose-based vaccine against Covid-19 that could be a 'game-changer'.

A No substitution required

B a nasal vaccine

C an aural vaccine

D a sense-based vaccine

Answer: B

12. **Select the option that can be used as a one-word substitute for the given group of words.**
A new project or business activity involving some risk

A Entrepreneur

B Venture (n)

C Experiment

D Taboo

Answer: B

13. **Select the most appropriate option to substitute the underlined segment in the given sentence. If there is no need to substitute it, select 'No substitution required'.**
Lavanya was happy to see that the tree they had planted the previous year has grow quite taller.

A No substitution required

Downloaded from cracku.in

B had grown quite tall

C had grow quite taller

D had grown quite tallest

Answer: B

SSC CGL Free Mock Test (Latest Pattern)

14. **The following sentence has been split into four segments. Identify the segment that contains a grammatical error.**
The sports day events / will be conducted / from 3:30 p.m. and 5:30 p.m. / on Saturday.

A The sports day events

B from 3:30 p.m. and 5:30 p.m.

C on Saturday

D will be conducted

Answer: B

15. **Select the option that expresses the given sentence in direct speech.**
The students asked the teacher where they could find the information for their project.

A The students said to the teacher, "Where can you find the information for our project?"

B The students asked the teacher, "Where can we find the information for our project?"

C The teacher said to the students, "Where you can find the information for your project."

D The teacher said to the students, "I will tell you where you can find the information for your project."

Answer: B

16. **Select the INCORRECTLY spelt word.**

A Possesions

B Irritation

C Invitation

D Protection

Answer: A

SSC CHSL Important Questions and Answers (Download PDF)

17. **Select the most appropriate synonym of the given word.**
Forbid

A Close

B Prohibit

C Adieu

Downloaded from cracku.in

D Encourage

Answer: B

18. **Select the most appropriate ANTONYM of the given word.**
Accustomed

A Terrific

B Fabulous

C Ordinary

D Unusual

Answer: D

19. **Sentences of a paragraph are given below in jumbled order. Arrange the sentences in the right order to form a meaningful and coherent paragraph.**
A. Humans work because they have to; they play because they want to.
B. The most useful definitions are those that clarify the relationship of sports to play, games and contests.
C. "Play," wrote the German theorist Carl Diem, "is purposeless activity, for its own sake, the opposite of work."
D. Sports are part of every culture, past and present, but each culture has its own definition of sports.

A ABCD

B DCBA

C DBCA

D BADC

Answer: C

SSC CHSL Study Material

20. **Select the most appropriate meaning of the given idiom.**
Thick as thieves

A Having a close friendship

B Being very dishonest

C Never helping anyone

D Telling lies all the time

Answer: A

Instructions [21 - 25]

In the following passage, some words have been deleted. Select the most appropriate option to fill in each blank.

Comprehension:
Meghalaya, a hilly state of India, is located in the northeastern part of the country. It is (1)_____ by the Indian state of Assam in the north and northeast and (2) _____ Bangladesh in the south and southwest. The state capital is (3) _____ hill town of Shillong, located in eastcentral Meghalaya. Meghalaya is an upland area formed by a (4)_____ block of the Deccan plateau. Its summits vary in (5) _____ from 4,000 to 6,000 feet (1,220 to 1,830 metres).

21. **Select the most appropriate option to fill in blank no.1.**

Downloaded from cracku.in

A bind

B bonded

C bounded

D bounding

Answer: C

22. **Select the most appropriate option to fill in blank no.2.**

A near

B with

C beside

D by

Answer: D

SSC CHSL Free App

23. **Select the most appropriate option to fill in blank no.3.**

A a

B one

C only

D the

Answer: D

24. **Select the most appropriate option to fill in blank no.4.**

A withdrawn

B standing

C removed

D detached

Answer: D

25. **Select the most appropriate option to fill in blank no.5.**

A distance

B rise

C elevation

D increase

Answer: C

Downloaded from cracku.in

Daily Free SSC Practice Set

General Intelligence

26. **Ruchi's husband's grandfather is Abhinav, whose grandson's father is Viyan. If Abhinav and his wife have only one son, how is Viyan related to Ruchi's husband?**

A Brother-in-law

B Uncle

C Cousin

D Father

Answer: D

Free SSC Study Material (18,000 Solved Questions)

27. **The sequence of folding a piece of paper and the manner in which the folded paper has been cm is shown in the following figures. How would this paper look when unfolded?**

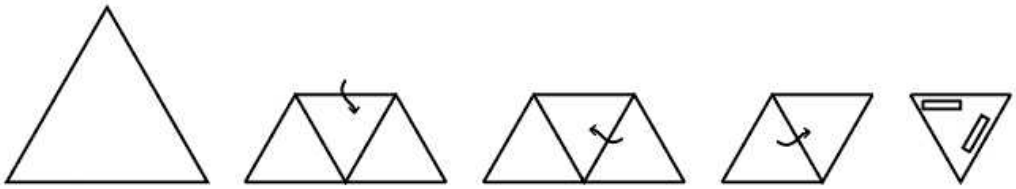

A

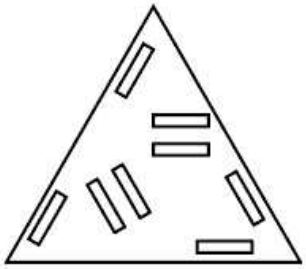

B

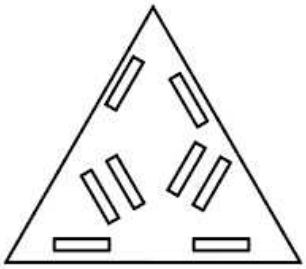

C

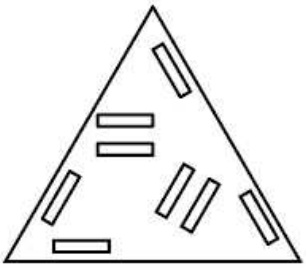

Downloaded from cracku.in

D 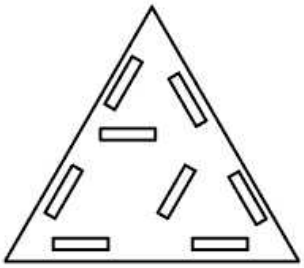

Answer: C

28. **Select the Venn diagram that best represents the relationship between the following classes.**
Statisticians, Men, Pathologists

A 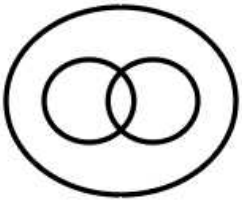

B 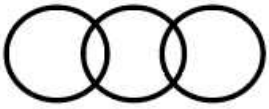

C 

D 

Answer: B

29. **A cube is made by folding the given sheet. In the cube so formed. what would be the symbol on the opposite side of 's'?**

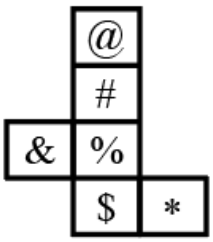

A *

B @

C #

D &

Answer: C

Downloaded from cracku.in

30. **Find the number of triangles in the given figure.**

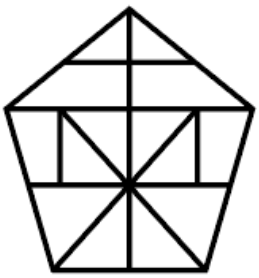

A 17

B 18

C 16

D 19

Answer: B

31. **Select the correct mirror image of the given figure when the mirror is placed at the right side.**

A



B



C



D

Answer: A

Downloaded from cracku.in

32. **Select the correct option that indicates the arrangement of the given words in the order in which they appear in an English dictionary.**
1.Inhaler
2.Inimitable
3.Inhabitant
4.Ingenuous
5.Inheritance

A 4, 3, 5, 1, 2

B 4, 5, 2, 1, 3

C 4, 1, 3, 5, 2

D 4, 3, 1, 5, 2

Answer: D

SSC Exam Update Videos & Free Study Material (YouTube Channel)

33. **Select the number from among the given options that can replace the question mark (?) in the following series.**
71, 56, 44, 35, 29, ?

A 26

B 20

C 29

D 23

Answer: A

34. **Select the option in which the numbers are related in the same way as are the numbers of the following set.**
47 : 58 : 71

A 72 : 81 : 90

B 89 : 98 : 106

C 76 : 89 : 105

D 68 : 80 : 88

Answer: A

35. **Four numbers have been given, out of which three are alike in some manner and one is different. Select the number that is different.**

A 463

B 308

C 137

D 229

Answer: B

Downloaded from cracku.in

Latest Job Updates on Telegram - Join here

36. **Four letter-clusters have been given, out of which three are alike in some manner and one is different. Select the letter-cluster that is different.**

A GKPJ

B TXBV

C KOLF

D QUFZ

Answer: B

37. **Select the option that is embedded in the given figure (rotation is NOT allowed).**

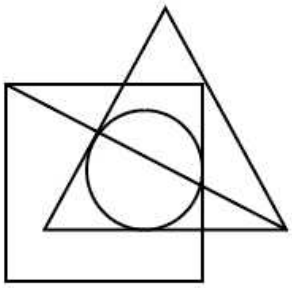

A

B 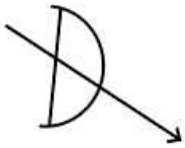

C 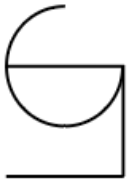

D

Answer: D

38. **In a certain code language, VICTORY is coded as 29472435 and HASTY is coded as 278119. How will SUBLIME be coded in that language?**

A 2143152558

B 2134152558

C 1514131285

Downloaded from cracku.in

D 1213141585

Answer: A

Join SSC Daily Quiz Telegram Group

39. **Read the given statements and conclusions carefully. Assuming that the information given in the statements is true, even if it appears to be at variance with commonly known facts, decide which of the given conclusions logically follow(s) from the statements.**
Statements:
Some dogs are bulls.
All bulls are donkeys.
Conclusions:
I. All dogs are donkeys.
II. Some donkeys are dogs.

A Both conclusions I and II follow.

B Only conclusion I follows.

C Only conclusion II follows.

D Neither conclusion I nor II follows.

Answer: C

40. **Select the option in which the words share the same relationship as that shared by the given pair of words.**
Mosquito : Swarm

A Monkey : Pride

B Shark : School

C Snake : Sleuth

D Cat : Murder

Answer: B

41. **Select the figure from among the given options that can replace the question mark(?) in the following series.**

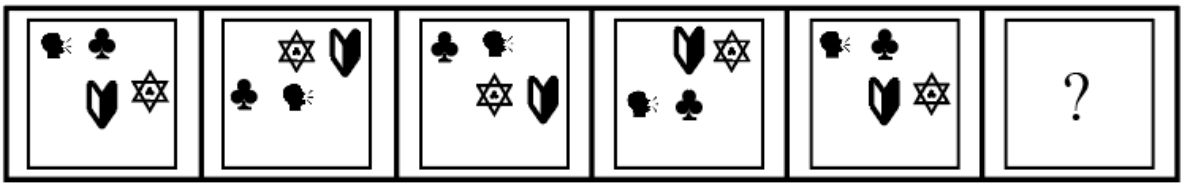

A

Downloaded from cracku.in

B

C

D

Answer: A

42. **Select the option that is related to the third number in the same way as the second number is related to the first number.**
18 : 163 : : 24 : ?

A 216

B 289

C 298

D 222

Answer: B

43. **Which two digits and signs need to be interchanged so as to balance the given equation?**
$65 + 13 - 119 \div 32 \times 8 = 175$

A 8 and 3; $\times$ and $\div$

B 9 and 8; $+$ and $\div$

C 5 and 8; $-$ and $\times$

D 2 and 9; $+$ and $\times$

Answer: B

44. **The District Transport Authority has started special bus services for college going students. One bus starts from village P. The number of girls in the bus is one-fourth of the number of**
boys. In village Q, 20 boys leave the bus at their college stop and ten girls enter the bus. Now the number of boys and girls is equal. How many students enter the bus in the beginning?

A 60

B 40

Downloaded from cracku.in

C 30

D 50

Answer: D

SSC CHSL Free Mock Test

45. **Select the option that is related to the third term in the same way as the second term is related to the first term.**
OUTSTAY : AOSTTUY :: ROUGHLY : ?

A GUROHLY

B ORGULHY

C GHLORUY

D GUORYLH

Answer: C

46. **Four options have been given, out of which three are alike in some manner and one is different. Select the option that is different.**

A Bangladesh

B Singapore

C Indonesia

D Sri Lanka

Answer: A

47. **Select the option that is related to the third word in the same way as the second word is related to the first word.**
Flock : Sheep :: Crowd : ?

A Swans

B Human

C Fly

D Fish

Answer: B

SSC CHSL Prevoius Papers (DOWNLOAD PDF)

48. **Select the combination of letters that when sequentially placed in the blanks of the given letter series will complete the series.**
k j i _ k _ _ i k j i _ k _ _ i

A j k j k j k

B i j i i j i

C k i j k i j

D i k j i k j

Downloaded from cracku.in

Answer: B

49. **In a certain code language, EXTREME is written as VCGIVNV. How will INITIAL be written in that language?**

A SMSGSZP

B RMSHRZP

C SNRGSAO

D RMRGRZO

Answer: D

50. **Study the given pattern carefully and select the number that can replace the question mark (?) in it.**

13	**50**	**8**
12	**39**	**5**
15	**51**	**?**

A 7

B 10

C 12

D 9

Answer: A

SSC CGL Previous Papers (DOWNLOAD PDF)

Quantitative Aptitude

51. **The value of** $\frac{5}{4} \times 2\frac{2}{3} \div \frac{5}{9} of 1\frac{1}{5} + \frac{2}{25} \times 4\frac{1}{6} \div \frac{2}{7} of 2\frac{1}{3}$ **is:**

A $5\frac{1}{2}$

B $3\frac{1}{2}$

C $2\frac{1}{2}$

D $1\frac{1}{2}$

Answer: A

SSC CGL Free Mock Test (Latest Pattern)

52. **If** $x + y + z = 13, x^2 + y^2 + z^2 = 91$ **and** $xz = y^2$**, then the difference between z and x is:**

A 3

B 8

C 5

D 9

Downloaded from cracku.in

Answer: B

53. **If $\tan x = \cot(48^\circ + 2x)$, and 0^\circ < x < 90^\circ $$, then what is the value of x ?**

A 12°

B 14°

C 16°

D 21°

Answer: B

54. **The radius of a sphere is 9 cm. It is melted and drawn imo a wire ofradius 0.3 cm. The length of the wire is:**

A 112 m

B 108 m

C 118 m

D 106 m

Answer: B

SSC CHSL Important Questions and Answers (Download PDF)

55. **Study the given graph and answer the question that follows.**

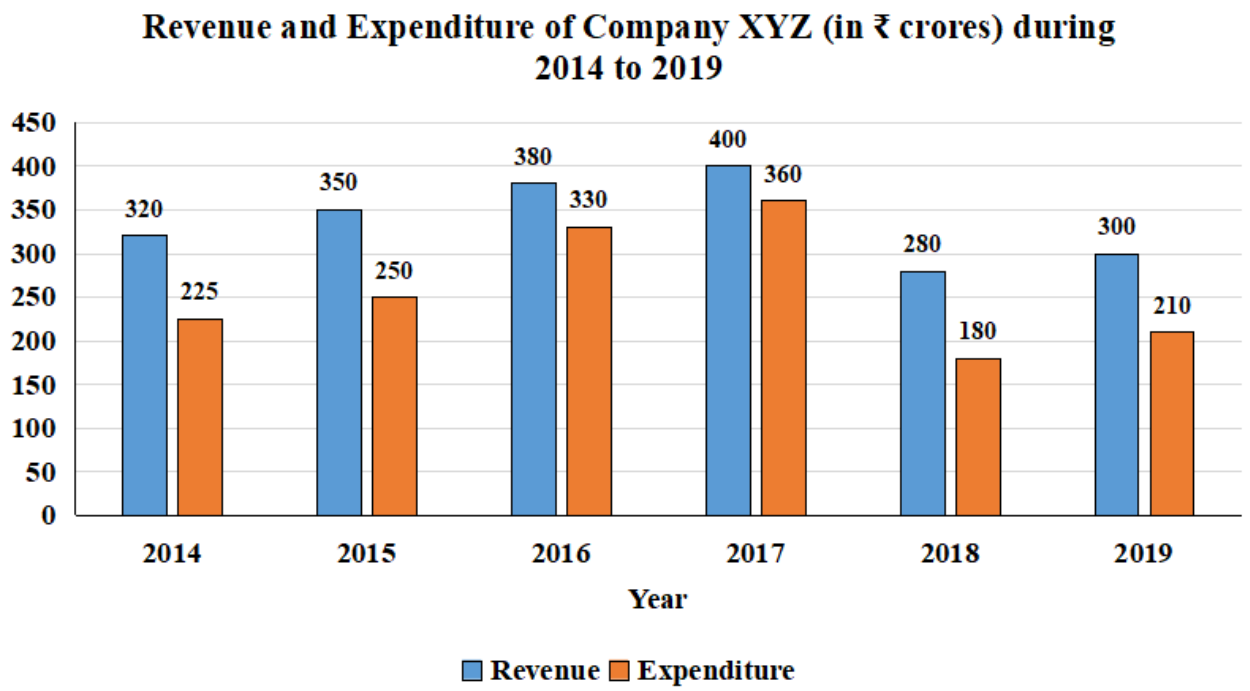

The torn I revenue of the company in 201 4, 20 16 and 2018 is what percentage of the total expenditure in 2015 to 1017 and 20 19 (correct to one decimal place)?

A 85.2%

B 84.3%

C 83.4%

Downloaded from cracku.in

D 81.6%

Answer: A

56. **If the five-digit number 672 xy is divisible by 3, 7 and 11, then what is the value of (6x + 5y) ?**

A 23

B 24

C 16

D 17

Answer: D

57. **In $\triangle XYZ, P$ is midpoint of side XZ and Q is a point on side XY such that QZ bisects PY. If XQ = 24 cm, then what is the length (in cm) of QY ?**

A 6

B 18

C 8

D 12

Answer: D

SSC CHSL Study Material

Downloaded from cracku.in

58. **Study the given pie-charts and answer the question that follows.**
The pie cha11s represent the popularity of ice-cream flavours among families in the years 20 19 and 2020.

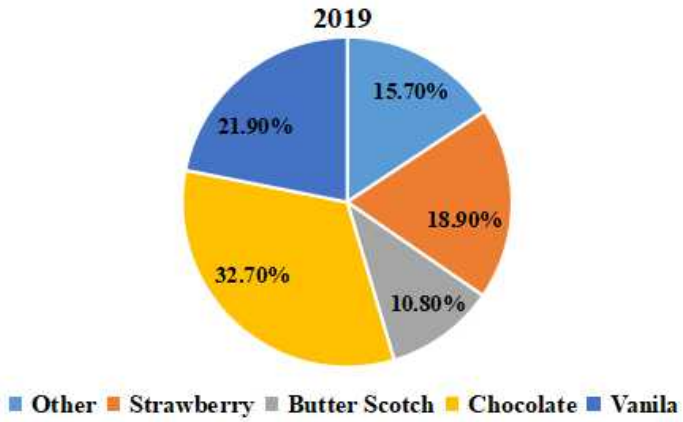

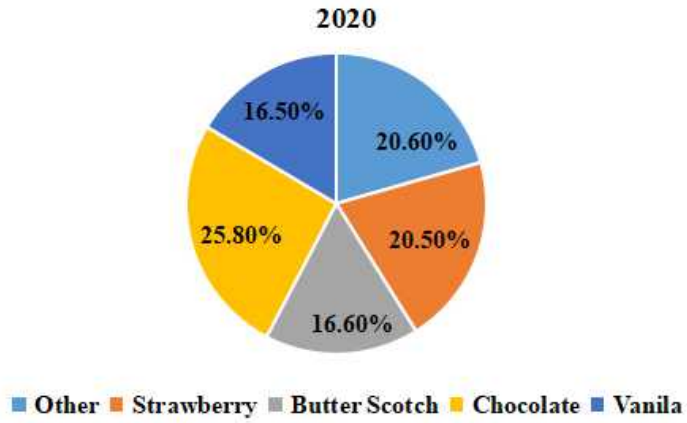

If l% increase resulted in annual additional sales of ₹ l0,000, then how much (in ₹), did the combined Strawbeny, other and Butterscotch sales increase from 2019 to 2020?

A 1,23,000

B 1,32,000

C 3,12,000

D 2,13,000

Answer: A

59. **The simple interest on a sum of ₹ 8,000 at a cenain rate per cent per annum for 3 years is ₹ 3,600. What will be the amoum (in ₹) of the same sum after 2 years at the same rate, if the interest is compounded 8-monthly?**

A 11,239

B 10,450

C 10,580

D 10,648

Answer: D

60. **Two successive discounrs each of x % on the marked price of an arricle are equal 10 a single discoum of ₹350. If the marked price of the article is ₹800, then the value of x is:**

A 27.5%

B 20%

Downloaded from cracku.in

C 25%

D 22.5%

Answer: C

SSC CHSL Free App

61. **The speed of a train is 78 km/h. It crosses a tunnel in 45 sand overtakes a person walking at a speed of 6 km/h. in the same direction, in 15s. The length (in m) of the tunnel is:**

A 675

B 650

C 975

D 780

Answer: A

62. **A bag courains coins of denomination ₹1, ₹2 and ₹5 in the ratio of 4 : 5 : 8. If the total value of these coins is ₹432, then what is the mmiber of ₹2 coins?**

A 40

B 30

C 50

D 60

Answer: A

63. **A chord PQ of a circle C_1 of radius 9.25 cm touches another circle C_2 that is concentric to C_1, and the radius of C_2 is 3 cm. What is the length (in cm) of PQ?**

A 12

B 19.5

C 17.5

D 15

Answer: C

Daily Free SSC Practice Set

64. **In an isosceles triangle ABC, AB = AC and AD is perpendicular to BC. If AD = 12 cm and the perimeter of $\triangle ABC$ is 36 cm. then the length of BC (in cm) is:**

A 5

B 12

C 10

D 13

Downloaded from cracku.in

Answer: C

65. **The price of a commodity increases by 28%. However, the expendimre on it increases by 12%. What is the percentage increase or decrea se in its consumption?**

A 16% Increase

B 12.5% Decrease

C 12.5% Increase

D 16% Decrease

Answer: B

66. **The coefficient of x^3y in $(x-2y)\times(5x+y)^3$ is:**

A 75

B -150

C 250

D -175

Answer: D

Free SSC Study Material (18,000 Solved Questions)

67. **A can complete a work in 20 days. while B can complete the same work in 25 days. Both worked togerher for 10 days and then C alone completed the remainuig work in 10 days. In how many days will A, B and C together complete the same work?**

A 10 days

B 5 days

C 8 days

D 12 days

Answer: A

68. **The average height of a certain number of students in a group is 155.6 cm. If 12 students having an average height of 150.5 cm join the group and students having an average height of 159 cm leave the group, the average height of the students in the group will decrease by 34 mm . What is the number of students. initially, in the group?**

A 30

B 25

C 40

D 20

Answer: D

69. **If $\cos\theta = \frac{3}{2}$, then the value of $\frac{2-\sin^2\theta}{1-\cot^2\theta} + (\sec^2\theta + \operatorname{cosec}\theta)$ is:**

Downloaded from cracku.in

A $\frac{25}{12}$

B $\frac{59}{24}$

C $-\frac{25}{12}$

D $-\frac{59}{24}$

Answer: B

1500+ Very Important Free SSC Solved Questions

70. **Study the given graph which shows the number of workers with their daily wages and answer the question that follows.**

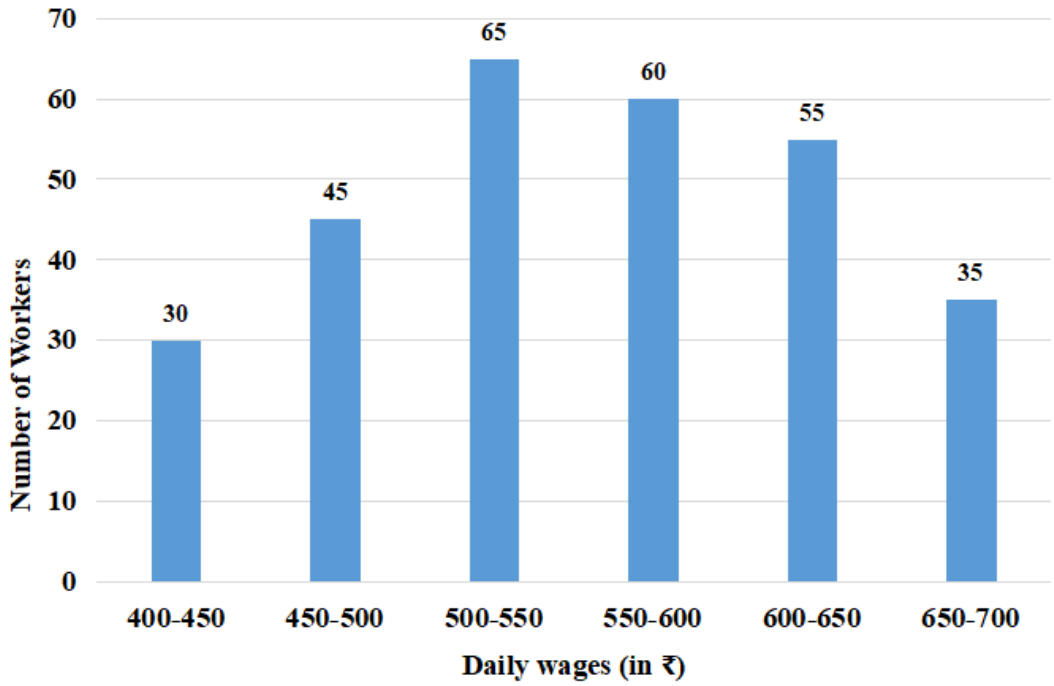

What is the ratio of the total number of workers whose daily wages are ₹450 or above but less than ₹500 to the total number of workers whose daily wages are ₹650 or above?

A 9 : 7

B 5 : 2

C 2 : 5

D 7 : 9

Answer: A

71. **The value of** $\frac{\tan 50^\circ + \sec 50^\circ}{\cot 40^\circ + \operatorname{cosec} 40^\circ} + \cos^2 65^\circ + \sin 65^\circ \cos 25^\circ + \tan 30^\circ$ **is:**

A $\frac{\sqrt{3}(\sqrt{3}+1)}{3}$

B $2+\sqrt{3}$

C $\frac{6+\sqrt{3}}{3}$

Downloaded from cracku.in

D $1+\sqrt{3}$

Answer: C

72. **In a circle, Ab and DC are two chords. When AB and DC are produced, they meet at P. If PC = 2.8 cm, PB = 3.15 cm and AB = 3.85 cm, then CD = ?**

A 5.075 cm

B 4.175 cm

C 6.975 cm

D 7.875 cm

Answer: A

SSC Exam Update Videos & Free Study Material (YouTube Channel)

73. **The pie chart shows the money spent by Aditya through credit cards of different banks. The total money spent by him through credit cards in a year is ₹3,60,000.**

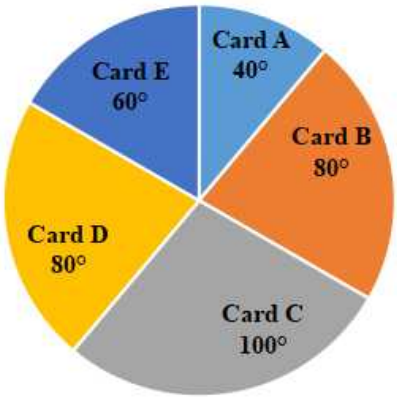

How much more money was spent through Card C as compared to Card D ?

A ₹2,000

B ₹40,000

C ₹20,000

D ₹1,80,000

Answer: C

74. **A person sold an article at a loss of 12% Had he sold it at a gain of 10.5%, he would have got ₹ 112.50 more. What is the original selling price (in ₹) of the article?**

A 440.00

B 560.00

C 552.50

D 500.00

Answer: A

75. **If** $x^2+4y^2+3z^2+\frac{19}{4}=2\sqrt{3}(x+y+z)$**, then the value of** $(x-4y+3z)$ **is:**

Downloaded from cracku.in

A $\frac{\sqrt{3}}{3}$

B $2\sqrt{3}$

C $\sqrt{3}$

D $\frac{\sqrt{3}}{2}$

Answer: C

Latest Job Updates on Telegram - Join here

General Awareness

76. **Who among the following was the first Indian Governor of the Reserve Bank of India?**

A KC Neogy

B CD Deshmukh

C Liaquat Ali Khan

D Morarji Desai

Answer: B

Join SSC Daily Quiz Telegram Group

77. **Which of the following hormone is secreted by brain that helps to regulate sleep-wake cycles?**

A Insulin

B Melatonin

C Oxytoxin

D Aldosterone

Answer: B

78. **Which of the following is one of the file formats used for web graphics?**

A .gif

B .exe

C .txt

D .docx

Answer: A

79. **In which of the following years did the Prime Minister of India, Narendra Modi, launch Atal Pension Yojana?**

A 2014

B 2018

Downloaded from cracku.in

C 2020

D 2015

Answer: D

80. **Shanti Swarup Bhatnagar Prize is associated with which of the following disciplines?**

A Sports

B Literature

C Music

D Science and Technology

Answer: D

81. **In which year did the Central Government of India appoint the States Reorganisation Commission?**

A 1958

B 1953

C 1950

D 1951

Answer: B

82. **In which of the following North Eastern states is the first ever specialised 'Ginger' Processing Plant being revived in December 2020?**

A Mizoram

B Assam

C Sikkim

D Meghalaya

Answer: D

SSC CHSL Free Mock Test

83. **Dandeli Wildlife Sanctuary is located in which of the following states?**

A Karnataka

B Jharkhand

C Sikkim

D Kerala

Answer: A

84. **In which of the following districts was Telangana's first rescue and rehabilitation centre for monkeys, launched in December 2020?**

Downloaded from cracku.in

A Narayanpet

B Nirmal

C Mulugu

D Adilabad

Answer: B

85. **Which of the following is a salt-water lake?**

A Pangong Tso

B Kolleru

C Nainital

D Loktak

Answer: A

SSC CHSL Prevoius Papers (DOWNLOAD PDF)

86. **FIFA World Cup 2022 venue, Ahmad Bin Ali Stadium, which was built by Indian construction giant Larsen & Turbo is located in which of the following countries?**

A Qatar

B Oman

C Bahrain

D Saudi Arabia

Answer: A

87. **Which of the following is a vector quantity?**

A Electric charge

B Electric flux

C Electric field

D Electric current

Answer: C

88. **According to the Constitution of India a Judge of the Supreme Court cannot be removed from office except by an order of the _____.**

A Vice President

B Attorney General

C Prime Minister

D President

Answer: D

Downloaded from cracku.in

SSC CGL Previous Papers (DOWNLOAD PDF)

89. **Who among the following persons was awarded the Padma Shri for social work in 2019?**

A Narsingh Dev Jamwal

B Ramaswami Venkataswami

C Anup Ranjan Pandey

D Devarapalli Prakash Rao

Answer: D

90. **Who was appointed as the first Surveyor General of India in 1815?**

A John Hodgson

B Thomas Hickey

C Henry Walpole

D Colin Mackenzie

Answer: D

91. **Kisan Fasal Rahat Yojana, which will replace (PMFBY) Pradhan Mantri Fasal Bima Yojna, has been launched by which of the following states government in December 2020?**

A Jharkhand

B Punjab

C Andhra Pradesh

D Chhattisgarh

Answer: A

SSC CGL Free Mock Test (Latest Pattern)

92. **Who among the following persons was elected, unopposed, as the President of Hockey India in November 2020?**

A Gyanendro Ningombam

B David John

C Mohd Mushtaque Ahmad

D Harendra Singh

Answer: A

93. **Where is Mount Diavolo, an important mountain peak in the Andaman and Nicobar Islands, located?**

A Great Nicobar

Downloaded from cracku.in

B North Andaman

C Middle Andaman

D South Andaman

Answer: C

94. **Raja Parba is a unique festival celebrating the onset of monsoon and the earth's womanhood. It is celebrated in which of the following states?**

A Bihar

B Odisha

C Meghalaya

D Uttar Pradesh

Answer: B

SSC CHSL Important Questions and Answers (Download PDF)

95. **Ustad Iqbal Ahmed Khan, a recipient of the Sangeet Natak Academy Award, belongs to the _____ Gharana.**

A Dilli

B Jaipur-Atrauli

C Gwalior

D Agra

Answer: A

96. **Which country ranked first in the 'Human Development Report 2020' released by the United Nations Development Programme?**

A Norway

B Germany

C Switzerland

D Hong Kong

Answer: A

97. **_____ is an advanced discipline that teaches students how to analyse and find patterns in large amounts of data.**

A Computer science

B Data science

C Software development

D Computer programming

Answer: B

Downloaded from cracku.in

SSC CHSL Study Material

98. **Who among the following sportsmen is the brand ambassador of SBOTOP, which is a global online betting platform?**

A Bajrang Punia

B Sushil Kumar

C Rohit Sharma

D Dwayne Bravo

Answer: D

99. **Which of the following parts of the body/glands maintains the body temperature?**

A Pituitary

B Adrenal

C Thyroid

D Hypothalamus

Answer: D

100. **_____'s foster mother Mahapajapati Gotami was the first woman to be ordained as a bhikkhuni.**

A Ashoka

B Buddha

C Arjuna

D Bindusara

Answer: B

SSC CHSL Free App

SSC CHSL Free Mock Test

SSC CHSL Prevoius Papers (DOWNLOAD PDF)

SSC CGL Previous Papers (DOWNLOAD PDF)

SSC CGL Free Mock Test (Latest Pattern)

SSC CHSL Important Questions and Answers (Download PDF)

SSC CHSL Study Material

Downloaded from cracku.in

SSC CHSL Free App

Daily Free SSC Practice Set

Free SSC Study Material (18,000 Solved Questions)

1500+ Very Important Free SSC Solved Questions

SSC Exam Update Videos & Free Study Material (YouTube Channel)

Latest Job Updates on Telegram - Join here

Join SSC Daily Quiz Telegram Group

Downloaded from cracku.in